Answer key The answers are filled in.

1 Which shape shows halves?

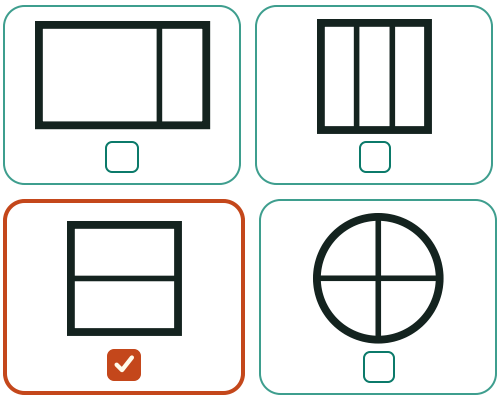

2



This rectangle is cut into equal parts. One part is shaded. What do we call the shaded part?

Check one: ☐ a whole ☐ a quarter ☑ a half

3



This rectangle is cut into equal parts. What do we call each part?

Check one: ☑ a half ☐ a quarter ☐ a whole

4 Which shape shows halves?

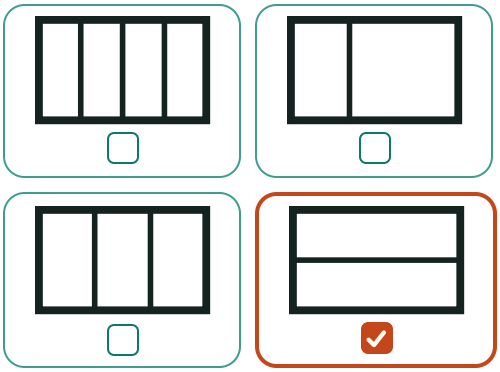

5



This circle is cut into equal parts. One part is shaded. What do we call the shaded part?

Check one: ☐ a half ☐ a whole ☑ a fourth

6 Shade one quarter of the rectangle.



One way is 1 shaded part.