larkit | Halves, thirds and fourths

Grade 2 · Fractions

Name _____ Date _____

1 Which shape is cut into eighths?



2 Which shape is cut into thirds?

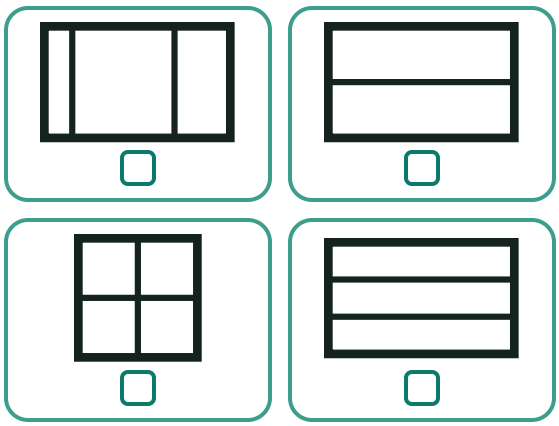

3 Which shape shows eighths?

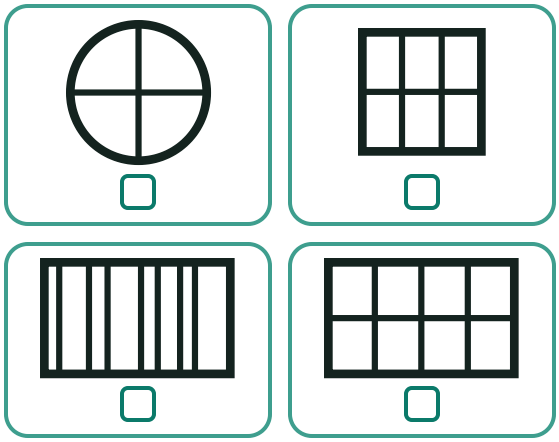

4



This rectangle is cut into equal parts. Which words name the whole rectangle?

Check one:

- ☐ four fourths
- ☐ four thirds
- ☐ two halves
- ☐ one fourth

Get the larkit app
On iPhone and iPad
Android: coming soon