Name _____ Date _____

1

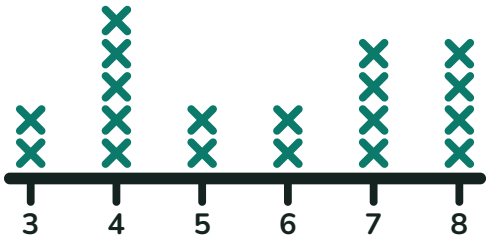

Length of shells (cm)

The line plot shows the lengths of some shells. What is the most common length, in centimeters?

2

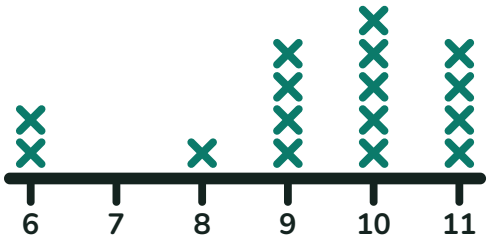

Length of sticks (inches)

The line plot shows the lengths of some sticks. Which sentence is true?

Check one:

- ☐ **More sticks are 10 inches long than any other length.**
- ☐ **More sticks are 11 inches long than any other length.**
- ☐ **There are 11 sticks in all.**

3

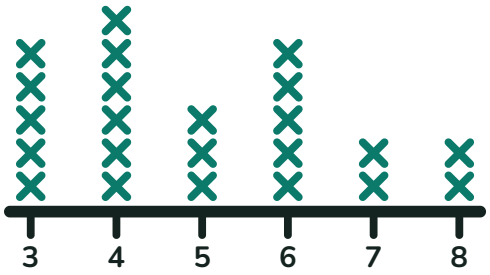

Length of leaves (cm)

The line plot shows the lengths of some leaves. What is the most common length, in centimeters?

4

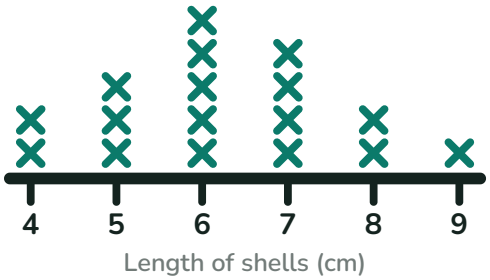

Length of shells (cm)

The line plot shows the lengths of some shells. Which sentence is true?

Check one:

- ☐ **There are 9 shells in all.**
- ☐ **More shells are 9 centimeters long than any other length.**
- ☐ **There are 17 shells in all.**

Get the larkit app
On iPhone and iPad
Android: coming soon