larkit | Count by 25s and 50s

Grade 3 · Numbers

Answer key The answers are filled in.

1 Each hop is 25. The hops start at 500. What number does the last hop land on?

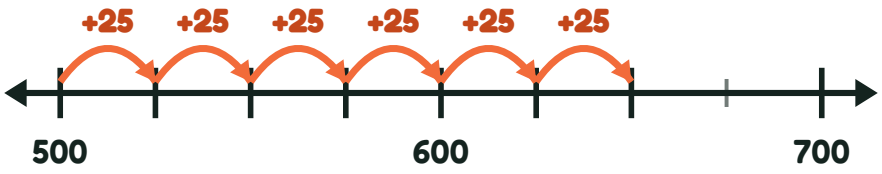

650

2 Each hop is 25. The hops start at 400. What number does the last hop land on?

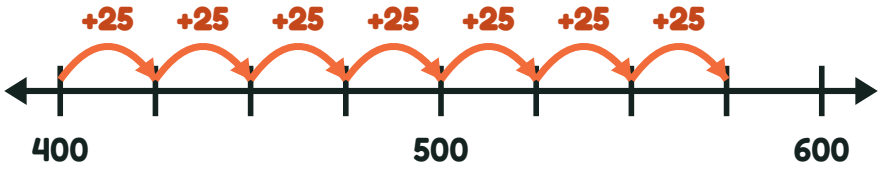

575

3 Each hop is 50. The hops start at 500. What number does the last hop land on?

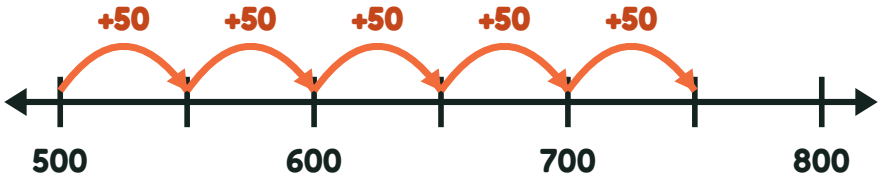

750

4 Each hop is 25. The hops start at 500. What number does the last hop land on?

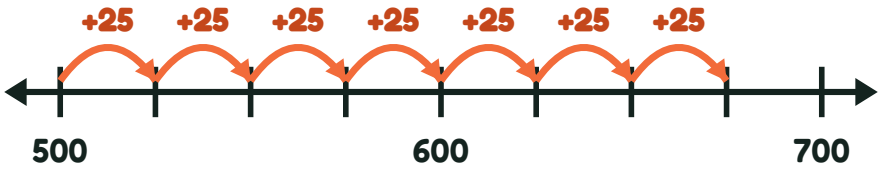

675