larkit | Count by 25s and 50s

Grade 3 · Numbers

Name _____ Date _____

1 Each hop is 50. The hops start at 700. What number does the last hop land on?

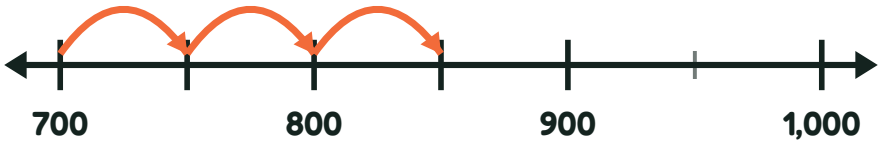

2 Each hop is 25. The hops start at 500. What number does the last hop land on?

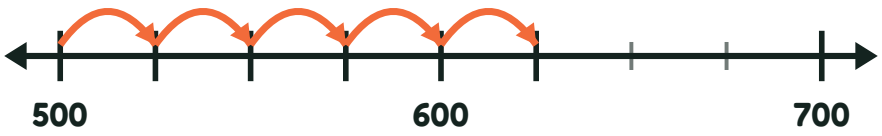

3 Each hop is 25. The hops start at 600. What number does the last hop land on?

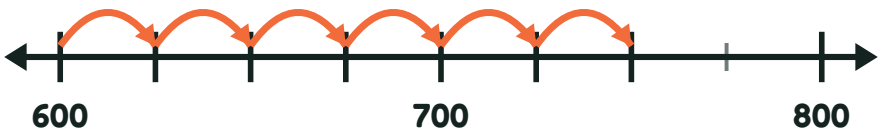

4 Each hop is 25. The hops start at 600. What number does the last hop land on?

