Answer key The answers are filled in.

1 Where is 0.83 on the number line? Draw a dot.

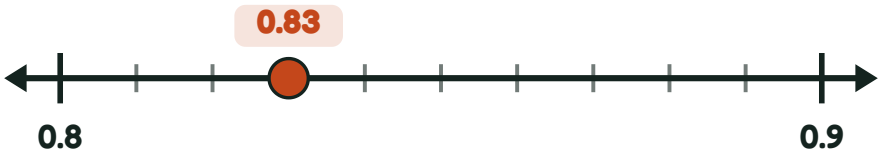

2 Where does $\frac{36}{100}$ go on the number line? Draw a dot.

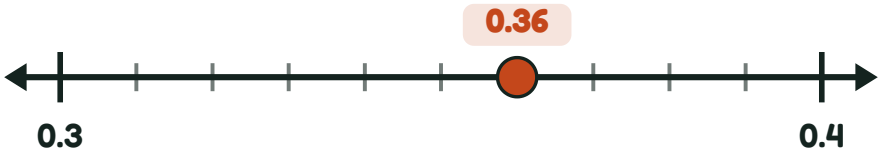

3 The number line from 1.1 to 1.2 is cut into 10 equal parts. Where is 1.13? Draw a dot.

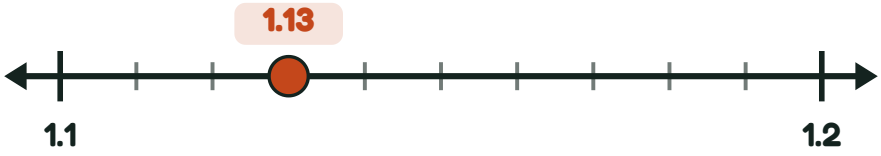

4 The number line from 2.3 to 2.4 is cut into 10 equal parts. What decimal does the dot show?



2.37

Score: ____ / 4