# Hours later

Grade 1 · Time

**Answer key** The answers are filled in.

**1** The school fair starts at 1 o'clock. The fair lasts 3 hours. Use the number line. At what hour does the fair end?

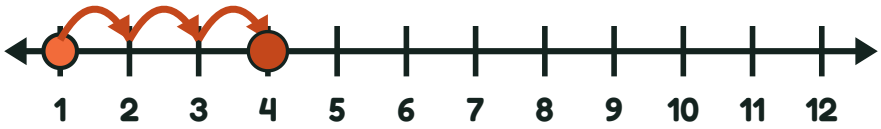


4

**2** The school fair starts at 1 o'clock. The fair lasts 2 hours. Use the number line. At what hour does the fair end?

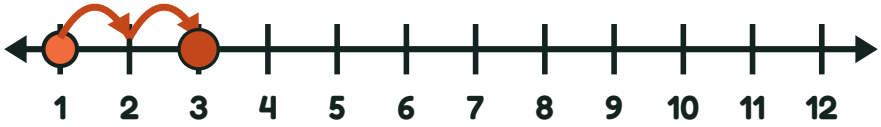


3

**3** Gia gets to the zoo at 9 o'clock. Gia stays for 2 hours. Use the number line. At what hour does Gia leave the zoo?

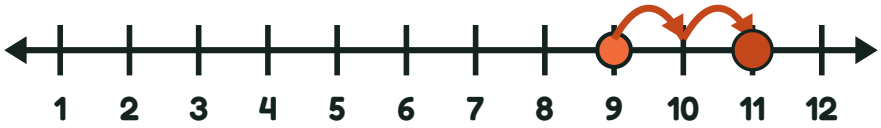


11

**4** Theo's family starts a picnic at 2 o'clock. The picnic lasts 2 hours. Use the number line. At what hour does the picnic end?

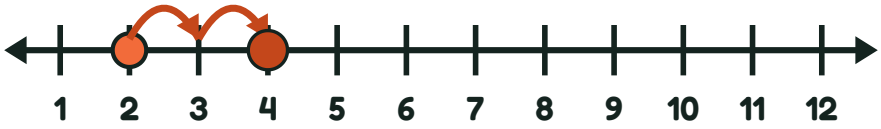


4