Answer key The answers are filled in.

1 Nico goes to a friend's house at 3 o'clock. Nico plays there for 3 hours. Use the number line. At what hour does Nico go home?

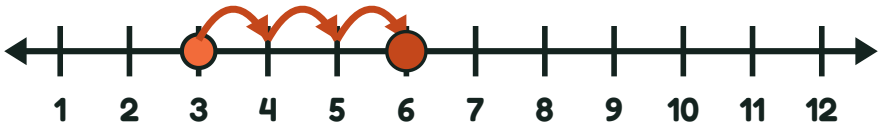

6

2 Zoe's family starts a picnic at 2 o'clock. The picnic lasts 3 hours. Use the number line. At what hour does the picnic end?

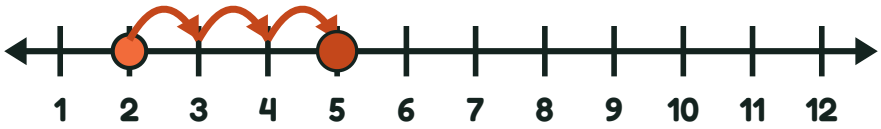

5

3 Sam starts a long car ride at 3 o'clock. The ride takes 2 hours. Use the number line. At what hour does the ride end?

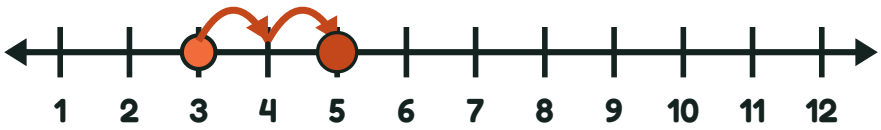

5

4 Ezra starts a long car ride at 8 o'clock. The ride takes 2 hours. Use the number line. At what hour does the ride end?

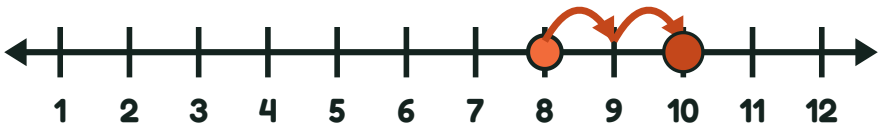

10

Score: / 4