Answer key The answers are filled in.

1 Show $2 \times \frac{2}{4}$ as 2 equal hops from 0. Where does each hop land? Draw the hops.

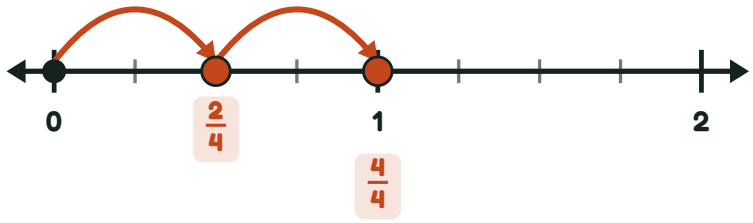

2 Start at 0 and make 2 hops of $\frac{3}{5}$. Where does each hop land? Draw the hops.

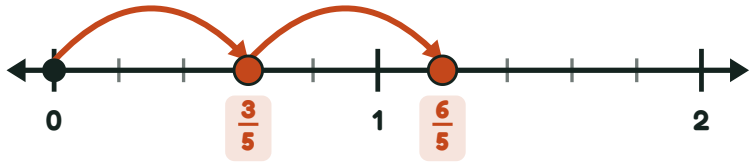

3 Each hop is $\frac{2}{3}$. Start at 0 and make 3 hops. Where does each one land? Draw the hops.

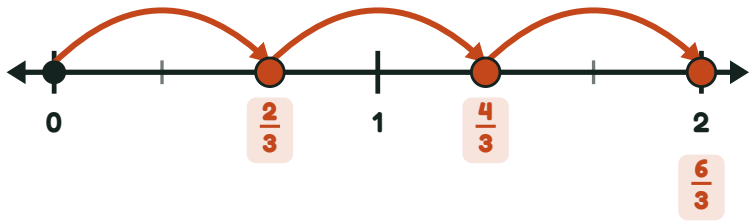

4 Show $2 \times \frac{3}{4}$ as 2 equal hops from 0. Where does each hop land? Draw the hops.

