Multiply a fraction by a whole number

Grade 4 · Fractions

Answer key The answers are filled in.

1 Show $2 \times \frac{2}{5}$ as 2 equal hops from 0. Where does each hop land? Draw the hops.

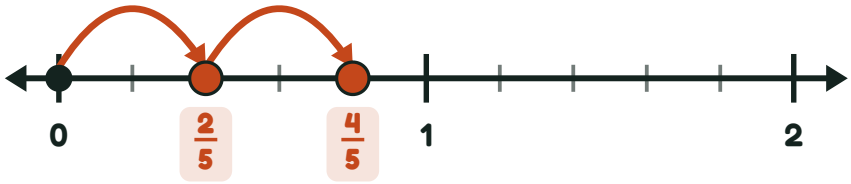

2 Show $2 \times \frac{3}{5}$ as 2 equal hops from 0. Where does each hop land? Draw the hops.

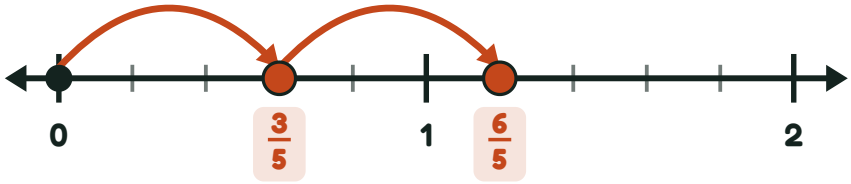

3 Each hop is $\frac{3}{5}$. Start at 0 and make 3 hops. Where does each one land? Draw the hops.

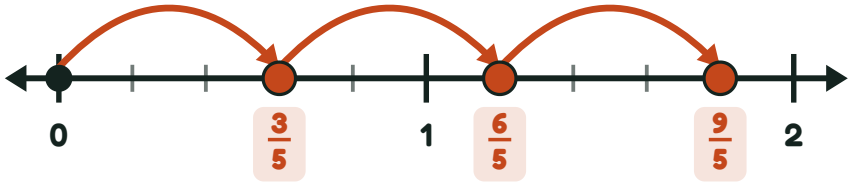

4 Show $4 \times \frac{2}{5}$ as 4 equal hops from 0. Where does each hop land? Draw the hops.

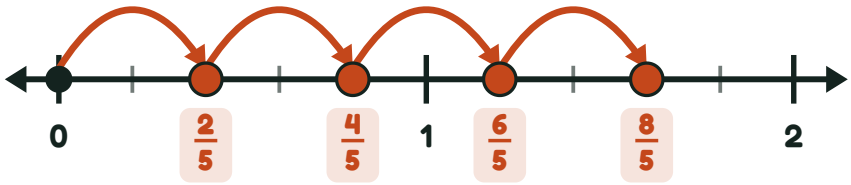

Score: ____ / 4