Name _____ Date _____

1 Ben starts at 0 on the number line and makes 7 equal jumps of 5. What number does Ben land on?

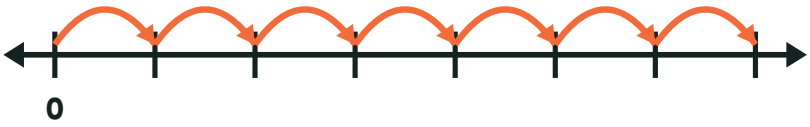

2 Ava makes 7 jumps of 2 on the number line, starting at 0. What number does Ava land on?

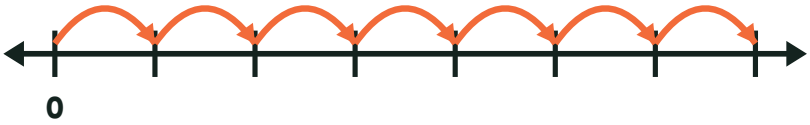

3 Tess starts at 0 on the number line and makes 7 equal jumps of 4. What number does Tess land on?

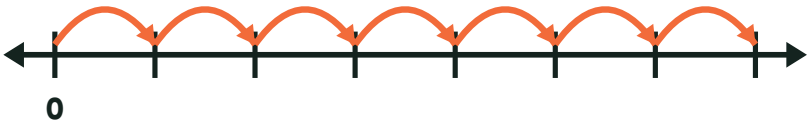

4 What number does Omar land on after 9 jumps of 3 on the number line, starting at 0?

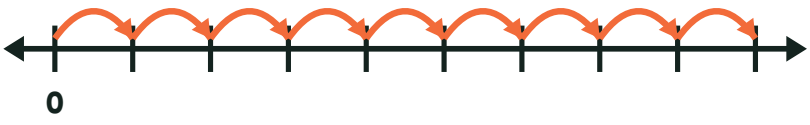

Get the larkit app
On iPhone and iPad
Android: coming soon