Answer key The answers are filled in.

1 What number does Nico land on after 8 jumps of 3 on the number line, starting at 0?

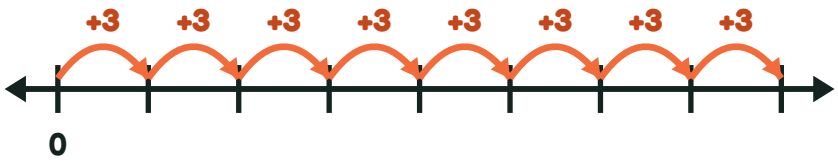

24

2 Nia starts at 0 on the number line and makes 6 equal jumps of 4. What number does Nia land on?

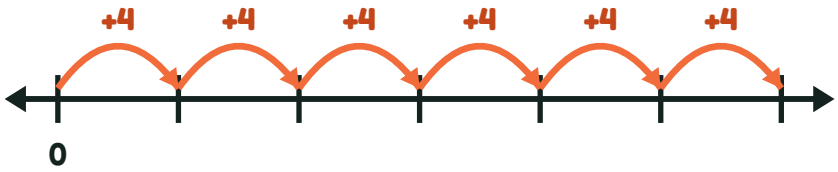

24

3 Dara makes 7 jumps of 4 on the number line, starting at 0. What number does Dara land on?

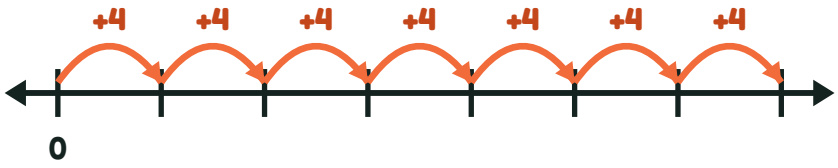

28

4 Sam starts at 0 on the number line and makes 9 equal jumps of 3. What number does Sam land on?

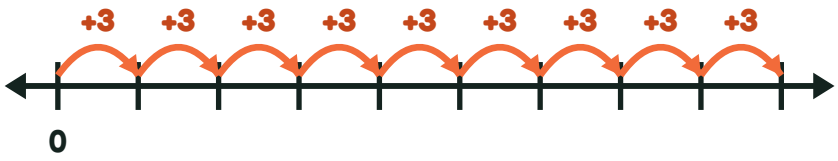

27

Score: / 4