larkit | Compare and order to 1,000,000

Grade 4 · Numbers

Answer key The answers are filled in.

1 Where is 440,000 on the number line? Draw a dot.

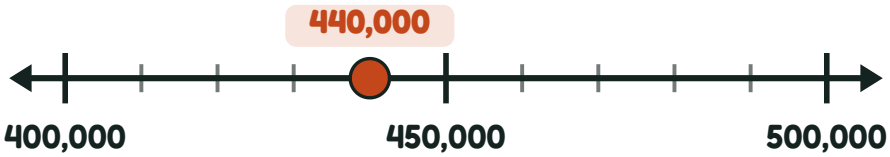

2 Where does 910,000 belong on the number line? Draw a dot.

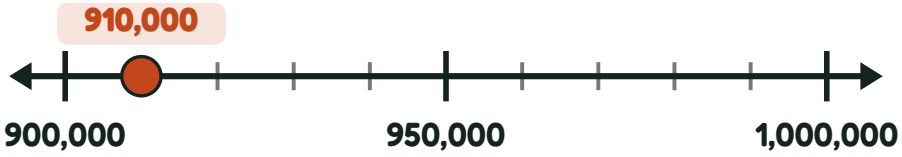

3 Where does 160,000 belong on the number line? Draw a dot.

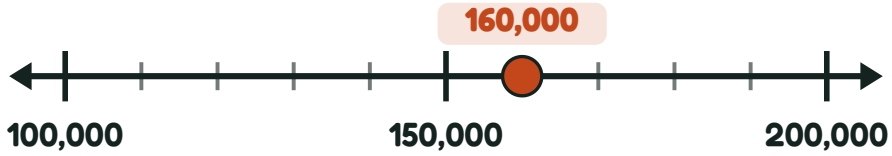

4 Where is 140,000 on the number line? Draw a dot.

