Answer key The answers are filled in.

1 The line from 5 to 6 has 10 equal parts. Where is 5.8 on it? Draw a dot.

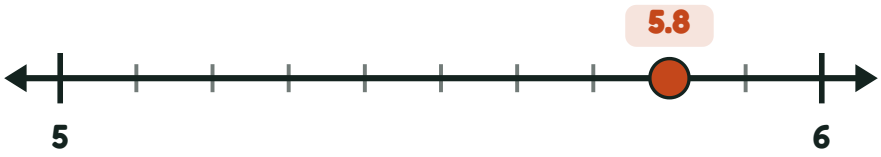

2 Where is 3.17 on the number line? Draw a dot.



3 Where is 2.86 on the number line? Draw a dot.

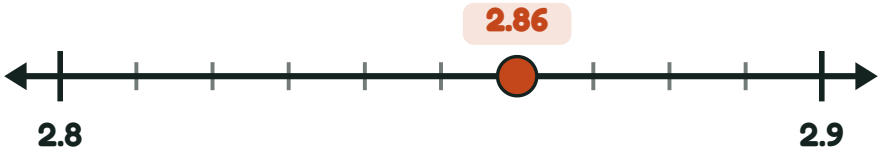

4 The line from 3 to 4 has 10 equal parts. Where is 3.9 on it? Draw a dot.

