Compare and order decimals

Answer key The answers are filled in.

1 Where is 1.81 on the number line? Draw a dot.

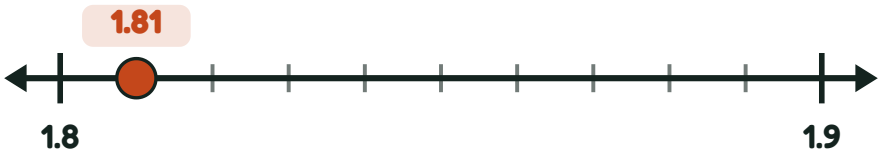

2 Where is 2.6 on the number line? Draw a dot.

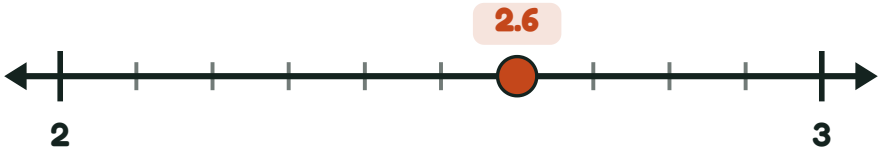

3 Where is 4.6 on the number line? Draw a dot.

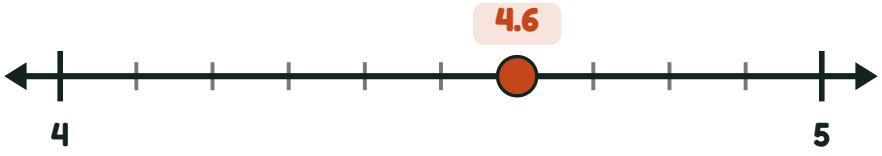

4 The line from 3 to 4 has 10 equal parts. Where is 3.8 on it? Draw a dot.

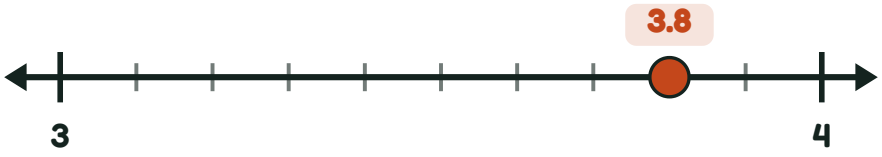

Score: ____ / 4