Answer key The answers are filled in.

1 Where is $\frac{1}{2}$ on the number line? Draw a dot.

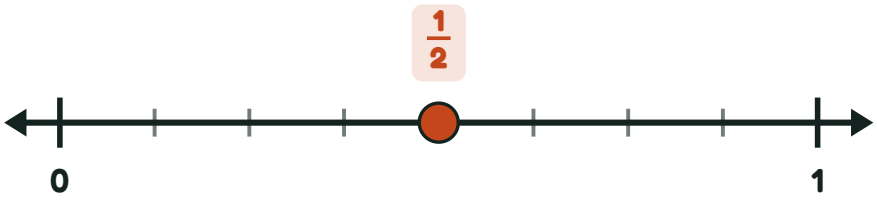

2 Where is $\frac{3}{2}$ on the number line? Draw a dot.

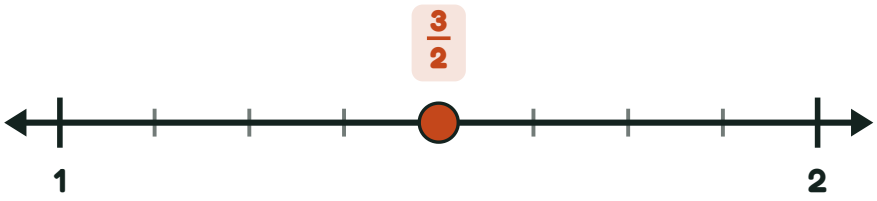

3 Where is $\frac{1}{4}$ on the number line? Draw a dot.

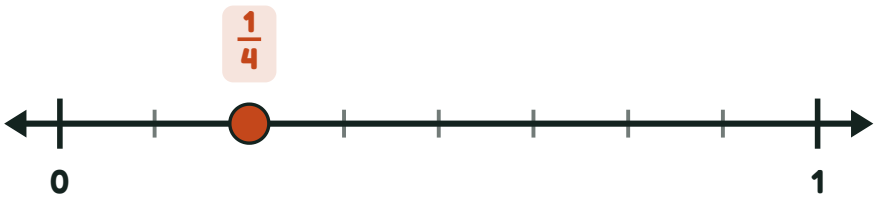

4 Where does $\frac{4}{3}$ go on this number line? Draw a dot.

