Skip count by 5s, 10s and 100s

Grade 2 · Numbers

Answer key The answers are filled in.

1 Each hop is 10. The hops start at 750. What number does the last hop land on?

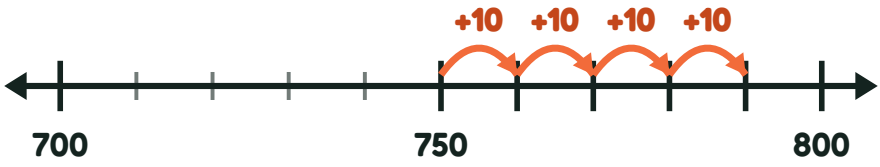

790

2 Each hop is 10. The hops start at 250. What number does the last hop land on?

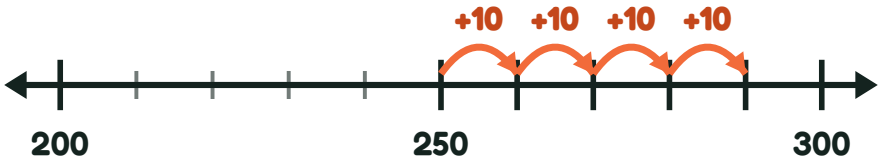

290

3 Each hop is 10. The hops start at 550. What number does the last hop land on?

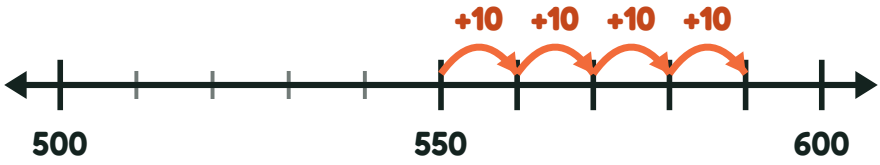

590

4 Each hop is 100. The hops start at 0. What number does the last hop land on?



300