Answer key The answers are filled in.

1 Each hop is 10. The hops start at 950. What number does the last hop land on?

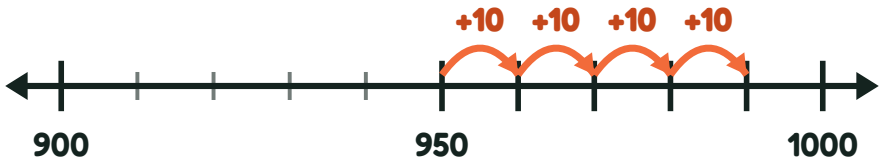

990

2 Each hop is 10. The hops start at 610. What number does the last hop land on?

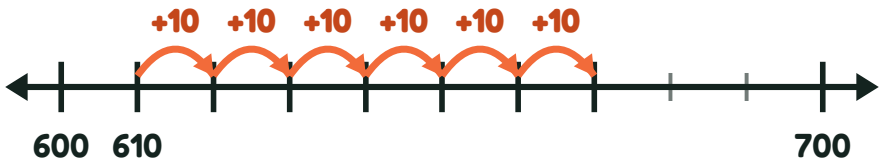

670

3 Each hop is 10. The hops start at 820. What number does the last hop land on?

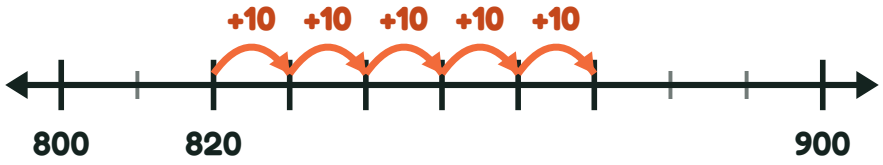

870

4 Each hop is 10. The hops start at 620. What number does the last hop land on?

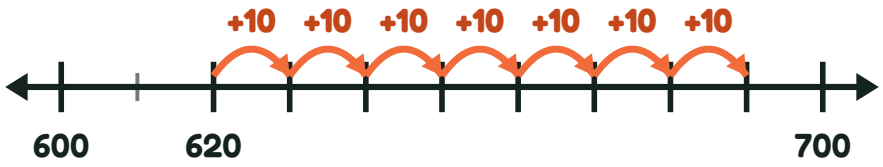

690