Skip count by 3s to 9s

Grade 3 · Multiply & Divide

Answer key The answers are filled in.

1 Each hop is 3. The hops start at 9. What number does the last hop land on?

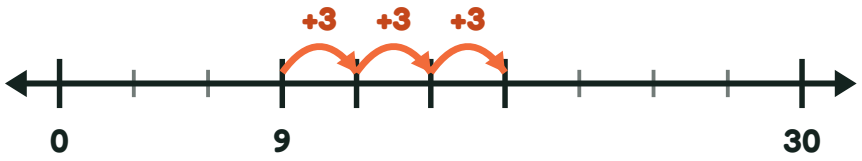

18

2 Each hop is 9. The hops start at 54. What number does the last hop land on?



81

3 Each hop is 8. The hops start at 8. What number does the last hop land on?

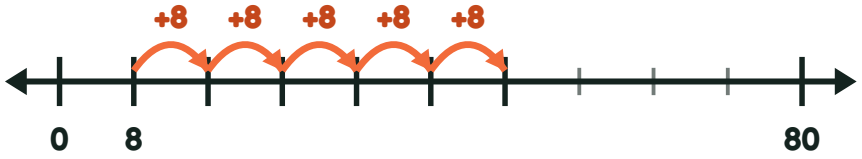

48

4 Each hop is 7, going back. The hops start at 63. What number does the last hop land on?

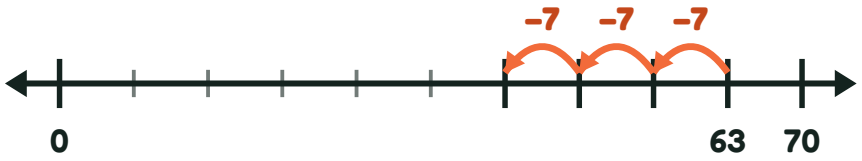

42