Strategies, patterns and the equal sign

Answer key The answers are filled in.

1 Uma counts up from 162 to 503 to find 503 – 162. What is 503 – 162?

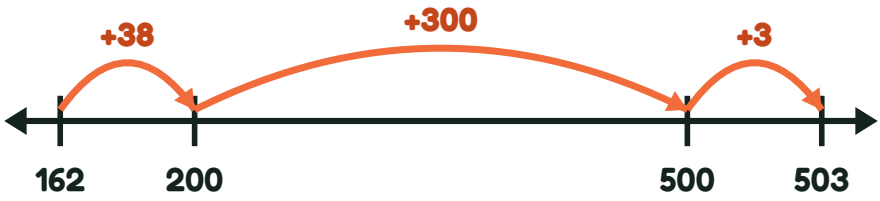

341

2 Isla counts up from 427 to 706 to find 706 – 427. What is 706 – 427?

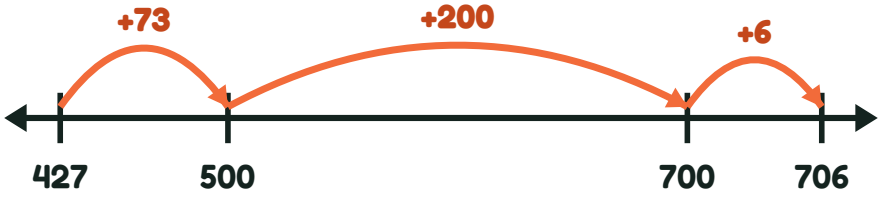

279

3 Gus counts up from 221 to 707 to find 707 – 221. What is 707 – 221?

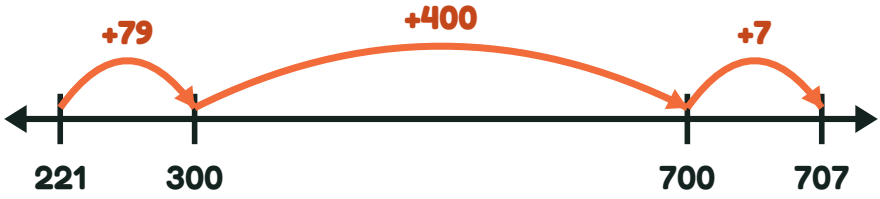

486

4 Leo counts up from 174 to 700 to find 700 – 174. What is 700 – 174?



526

Score: ____ / 4