larkit

Strategies, patterns and the equal sign

Grade 3 · Add & Subtract

Answer key The answers are filled in.

1 Kai counts up from 331 to 700 to find 700 – 331. What is 700 – 331?

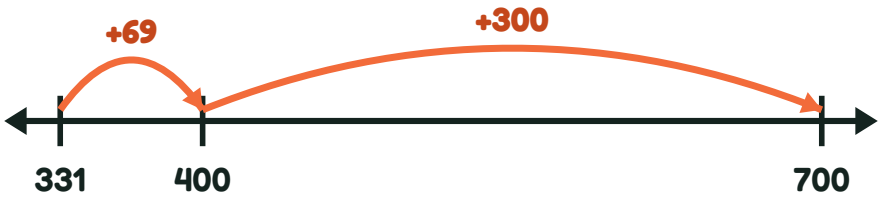

369

2 Wren counts up from 366 to 904 to find 904 – 366. What is 904 – 366?

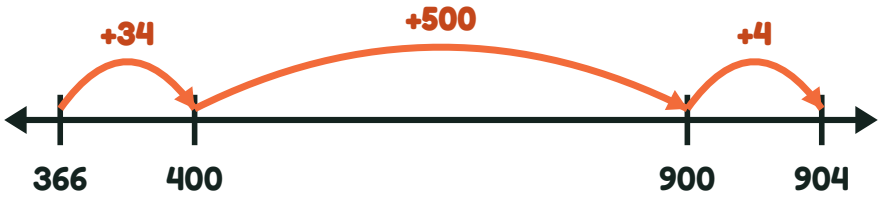

538

3 Finn counts up from 338 to 508 to find 508 – 338. What is 508 – 338?

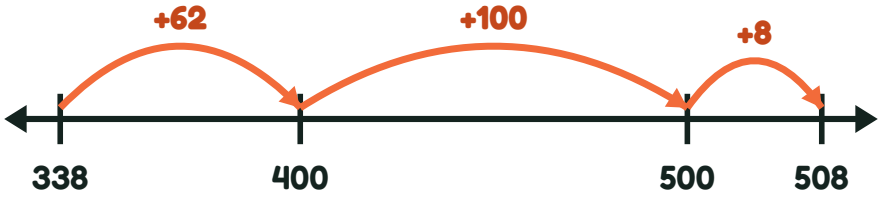

170

4 Cora counts up from 477 to 901 to find 901 – 477. What is 901 – 477?

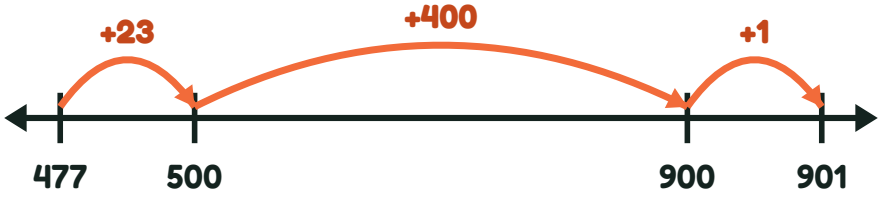

424