Answer key The answers are filled in.

1 Count up on the number line. What is 73 – 58?

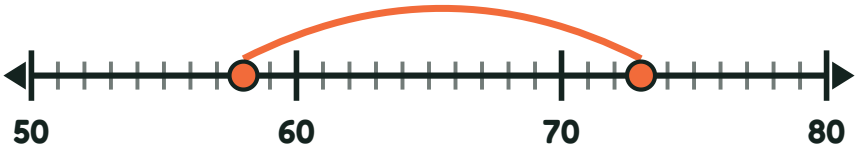

15

2 Count up on the number line. What is 36 – 17?

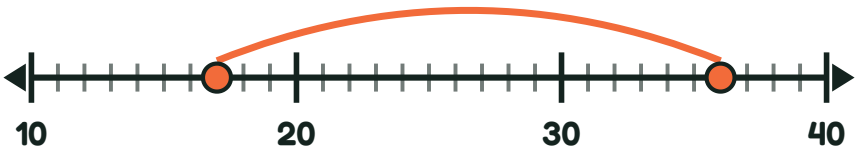

19

3 Count up on the number line. What is 51 – 26?

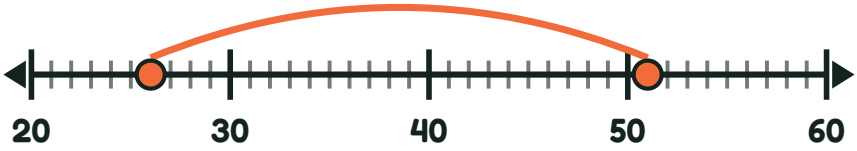

25

4 Count up on the number line. What is 51 – 38?

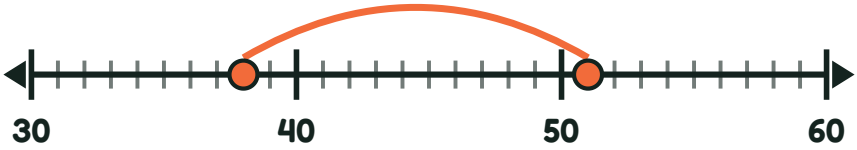

13