Name _____ Date _____

1 Count up on the number line. What is 73 – 58?

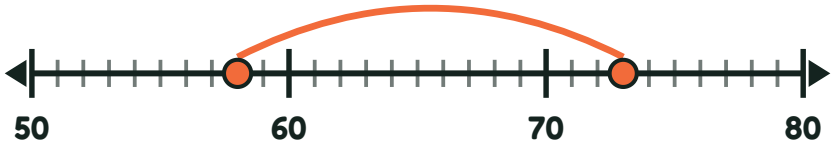

2 Count up on the number line. What is 36 – 17?

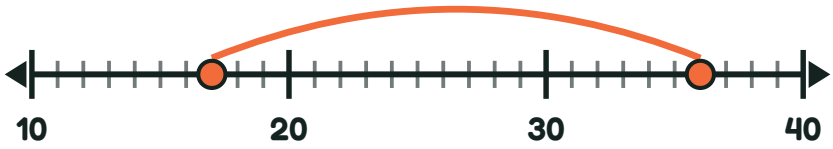

3 Count up on the number line. What is 51 – 26?

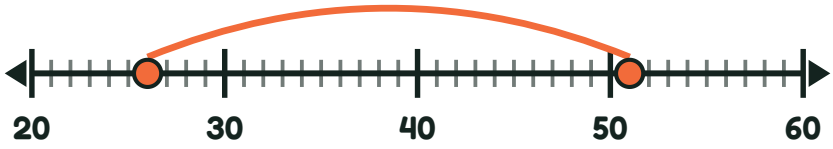

4 Count up on the number line. What is 51 – 38?

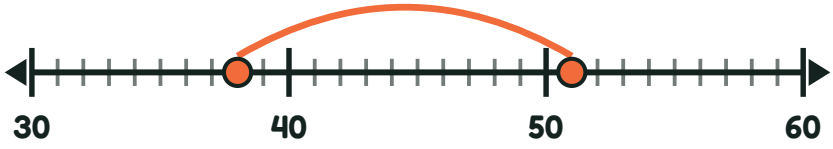

Get the larkit app
On iPhone and iPad
Android: coming soon