Answer key The answers are filled in.

1 Count up on the number line. What is 86 – 47?

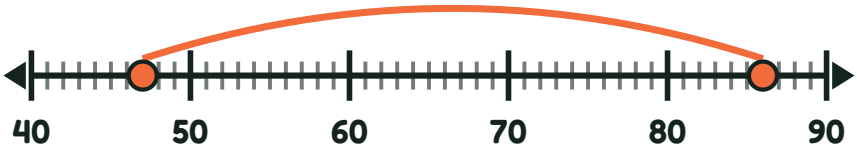

39

2 Count up on the number line. What is 86 – 49?

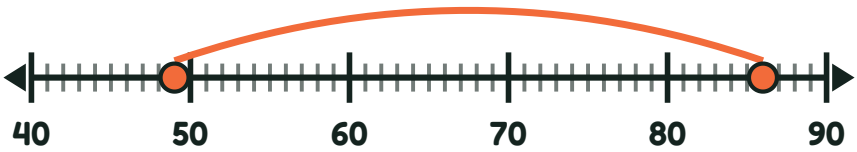

37

3 Count up on the number line. What is 45 – 26?

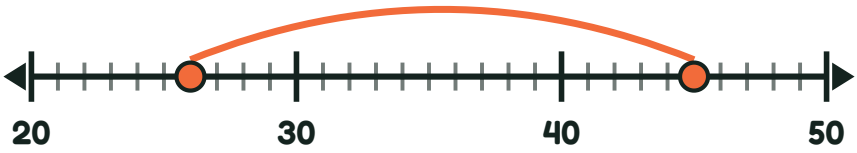

19

4 Count up on the number line. What is 61 – 26?

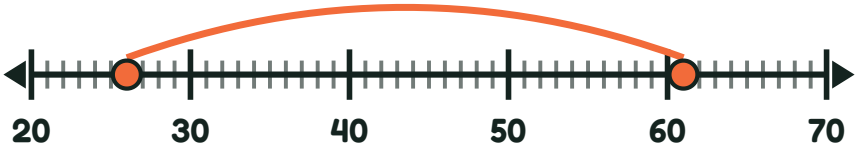

35