Name _____ Date _____

1 Count up on the number line. What is 86 – 47?

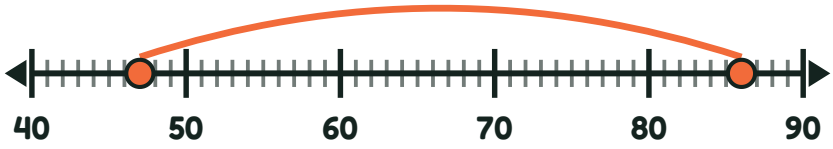

2 Count up on the number line. What is 86 – 49?

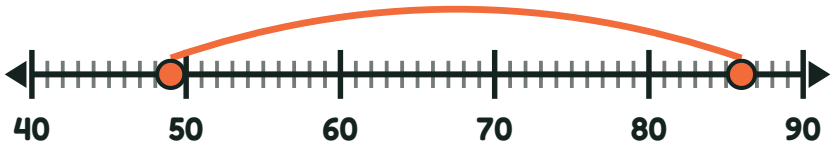

3 Count up on the number line. What is 45 – 26?

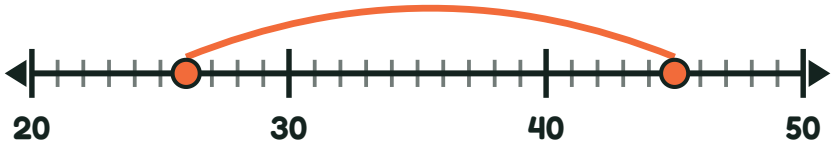

4 Count up on the number line. What is 61 – 26?

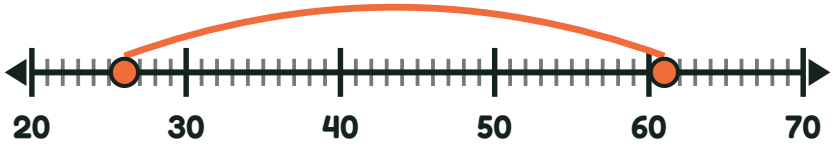

Get the larkit app
On iPhone and iPad
Android: coming soon