Answer key The answers are filled in.

1 What number goes in the box? 11 is 10 and □.

1

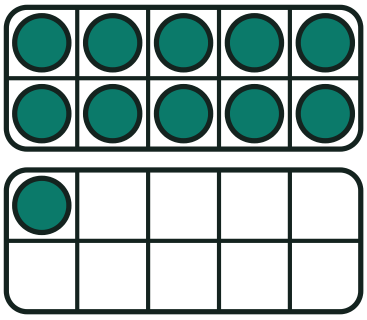

2 What number goes in the box? 18 is 10 and □.

8



3 What number goes in the box? 17 is 10 and □.

7



4 Draw 15 counters on the ten frames. Fill one ten frame first.

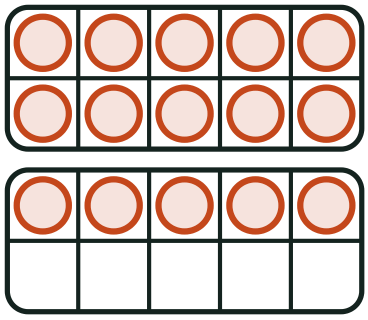

One way is 10 and 5.

5



Which number sentence matches the ten frames?

Check one:

- [x] 10 + 9 = 19
- [ ] 1 + 9 = 10
- [ ] 10 + 1 = 11

6 What number goes in the box? 13 is 10 and □.

3

