Teen numbers: ten and some more

Kindergarten · Numbers

Name _____ Date _____

1 What number goes in the box? 11 is 10 and ☐.

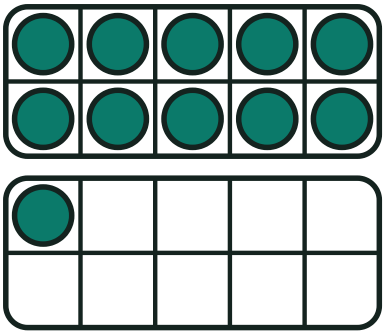

2 What number goes in the box? 18 is 10 and ☐.



3 What number goes in the box? 17 is 10 and ☐.



4 Draw 15 counters on the ten frames. Fill one ten frame first.

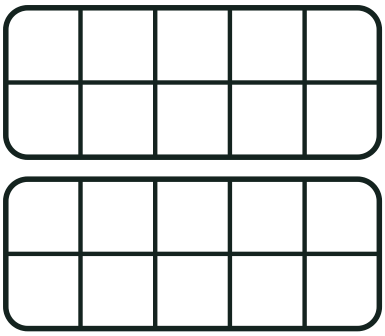

5



Which number sentence matches the ten frames?

Check one: ☐ 10 + 9 = 19 ☐ 1 + 9 = 10 ☐ 10 + 1 = 11

6 What number goes in the box? 13 is 10 and ☐.



Get the larkit app
On iPhone and iPad
Android: coming soon